Funktionen (am Graphen erkennen) **Lösungen+** **Übungen**

Aufgabe 1

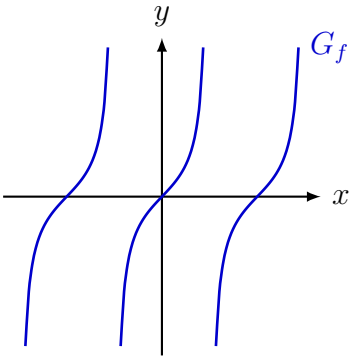

Tangensfunktion: $f(x) = \tan(x)$

Aufgabe 2

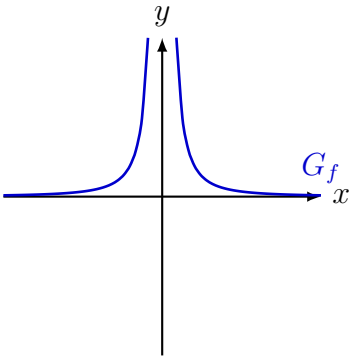

Potenzfunktion: $f(x) = x^{-2n}$ $(n \in \mathbb{N})$

Aufgabe 3

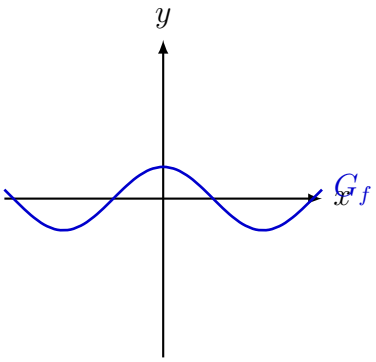

Cosinusfunktion: $f(x) = \cos(x)$

Aufgabe 4

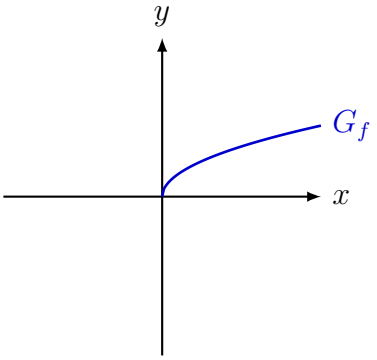

Wurzelfunktion: $f(x) = \sqrt[n]{x}$

Aufgabe 5

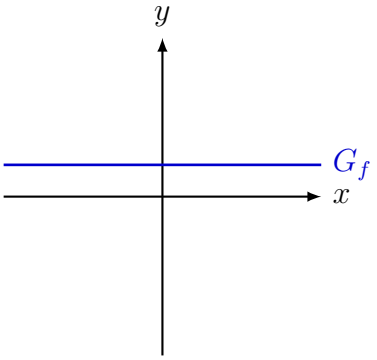

konstante Funktion: $f(x) = c$

Aufgabe 6

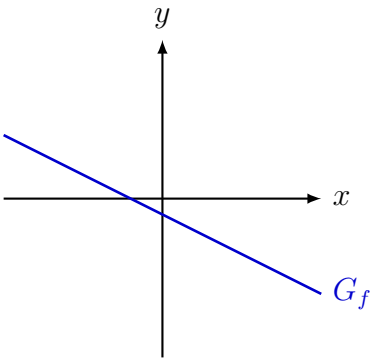

(affin) lineare Funktion: $f(x) = ax + b$

Aufgabe 7

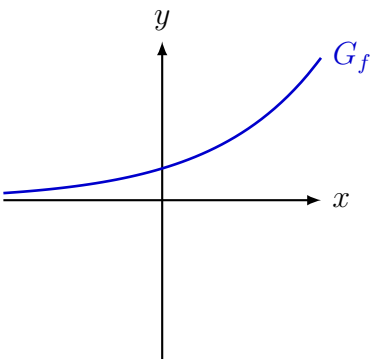

Exponentialfunktion: $f(x) = b^x$ $(b > 1)$

Aufgabe 8

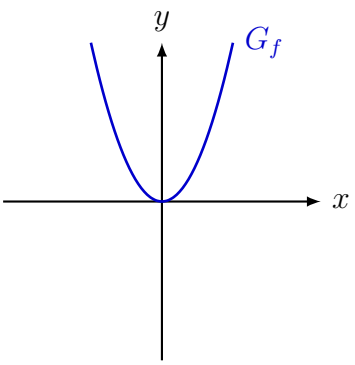

Potenzfunktion: $f(x) = x^{2n}$ $(n \in \mathbb{N})$

Aufgabe 9

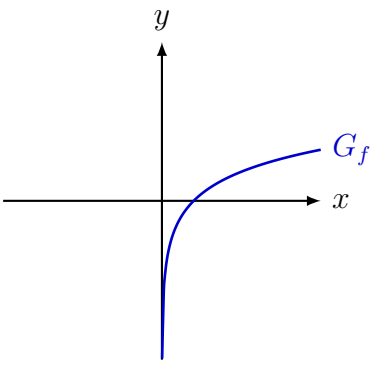

Logarithmusfunktion: $f(x) = \log_b x$ $(b > 1)$

Aufgabe 10

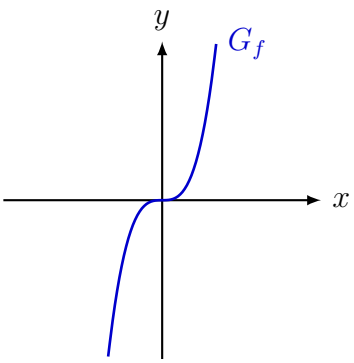

Potenzfunktion: $f(x) = x^{2n+1}$ $(n \in \mathbb{N})$

Aufgabe 11

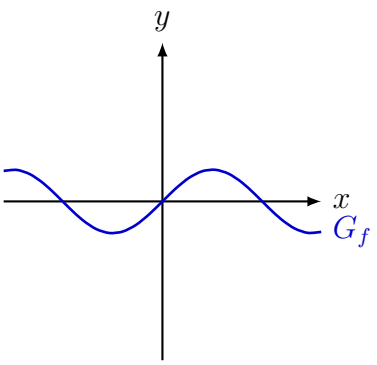

Sinusfunktion: $f(x) = \sin(x)$

Aufgabe 12

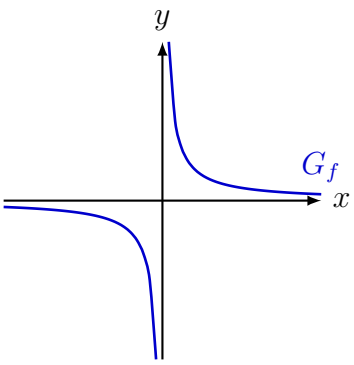

Potenzfunktion $f(x) = x^{-2n+1}$ $(n \in \mathbb{N})$